① Benenne jeweils die angegebenen Punkte oder Strecken / Geraden.

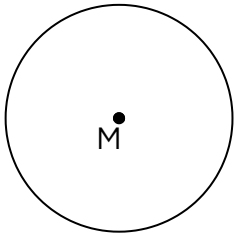

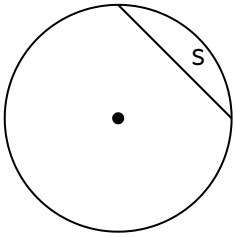

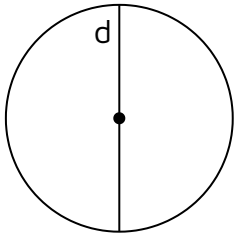

M: _____ s: _____ d: _____

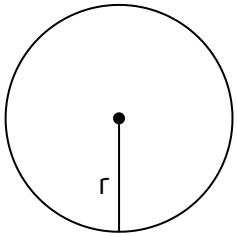

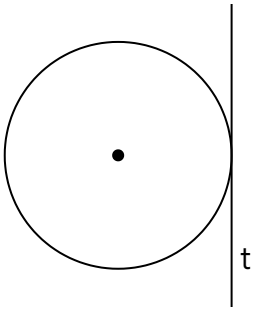

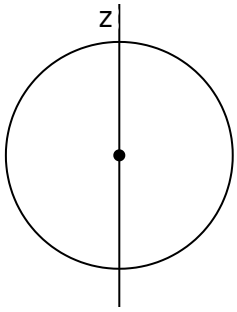

r: _____ t: _____ z: _____

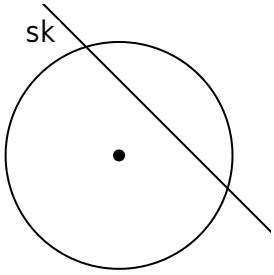

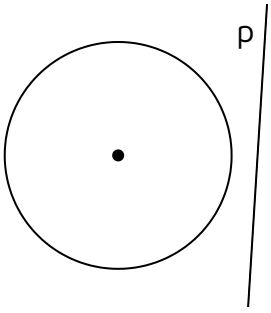

sk: _____ p: _____

Angaben zu den Urhebern und Lizenzbedingungen der einzelnen Bestandteile dieses Dokuments finden Sie unter
https://www.tutory.de/entdecken/dokument/uet-nr-1-der-kreis